G. D. GOENKA PUBLIC SCHOOL, SRINAGAR

SUBJECT – MATHEMATICS GRADE-2 Dated-14-09-21

ASPECT: SUPPORTING CONTENT

WEEK 8 (DAY 2)

SKILL SHEET - 3

NOTE: Refer to page 3 of Math Speed Book and complete the given questions (exempt Q7)

1. **Circle groups of 3. How many groups are there?**

5 groups of 3's = 5 x 3 = 15



2. **Write the number name of 128.**

One hundred twenty eight

3. **If you fold on the dotted line, will part A match Part B?**

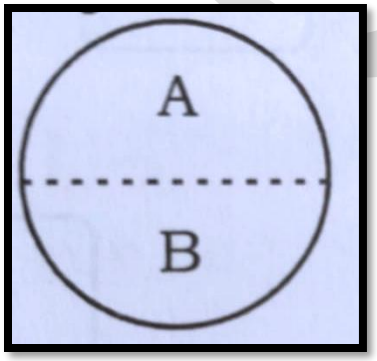

YES ✓ NO

4. **Put >, < or = sign.**

74 [>] 34

5. **Tick the box with smaller shape?**

A) ☐

B) ☐

6. **44 – 1 =** 43

8. **8 tens + 4 ones =** 84

9. **Write the numbers 26, 12, 62 and 46 from the smallest to the biggest.**

12 | 26 | 46 | 62

10. **Cross out 5 balloons. How many are left?**

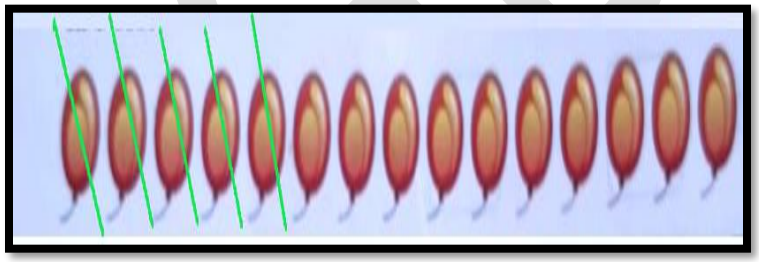

Total number of balloons = 15

Number of balloons crossed =5

15 – 5 = 10

Number of balloons left = 10

Note:

Self attempt skill sheet 4 on page no-4 and exempt Q-3 in the skill sheet 4